Visual Place Value (Less than 20)

Name:

Fill in the blanks to find the amounts.

Ex)

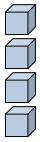

0 tens 4 ones

1)

_____ tens _____ ones

2)

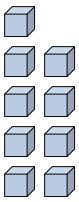

_____ tens _____ ones

3)

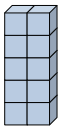

_____ tens _____ ones

4)

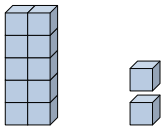

_____ tens _____ ones

5)

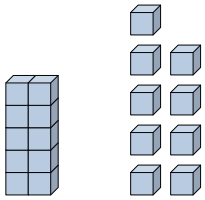

_____ tens _____ ones

6)

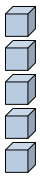

_____ tens _____ ones

7)

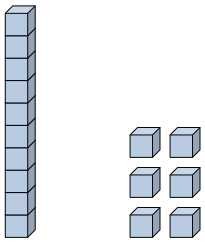

_____ tens _____ ones

8)

_____ tens _____ ones

9)

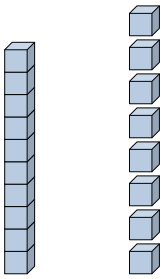

_____ tens _____ ones

10)

_____ tens _____ ones

11)

_____ tens _____ ones

Answers

Ex. 4

1. _____
2. _____
3. _____
4. _____
5. _____
6. _____
7. _____
8. _____
9. _____
10. _____
11. _____

Visual Place Value (Less than 20) Name: **Answer Key**

Fill in the blanks to find the amounts.

Ex)

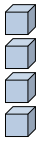

0 tens 4 ones

1)

0 tens 1 ones

2)

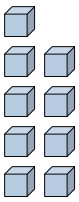

0 tens 9 ones

3)

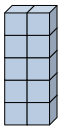

1 tens 0 ones

4)

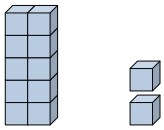

1 tens 2 ones

5)

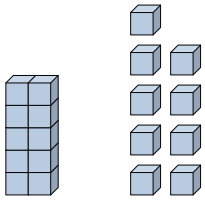

1 tens 9 ones

6)

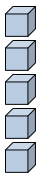

0 tens 5 ones

7)

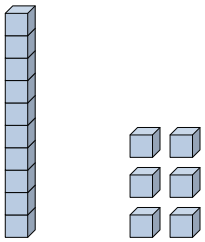

1 tens 6 ones

8)

0 tens 7 ones

9)

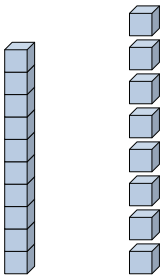

1 tens 8 ones

10)

0 tens 2 ones

11)

0 tens 3 ones

Answers

Ex.	4
1.	1
2.	9
3.	10
4.	12
5.	19
6.	5
7.	16
8.	7
9.	18
10.	2
11.	3